Pre-Algebra Bell-ringer 5/2/16

Suppose the two solids are similar. Find the missing surface area or dimension.

1

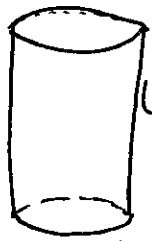

SA = 164 in²

SA = ?

2

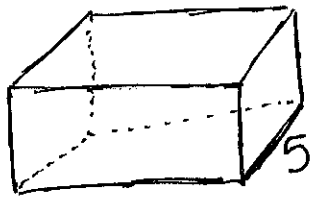

SA = 36 in²

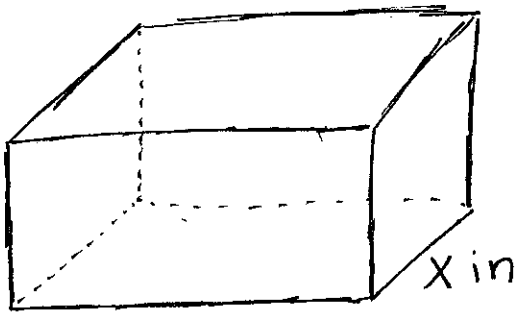

SA = 576 in²